Drumuri cu săgeți prin zăpadă

Pornește din căsuța marcată. Fiecare săgeată înseamnă un pas. Scrie coordonatele căsuței în care ajungi.

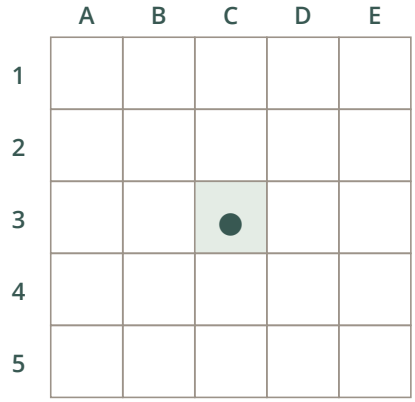

↓ ← ↓ ↑

= _____

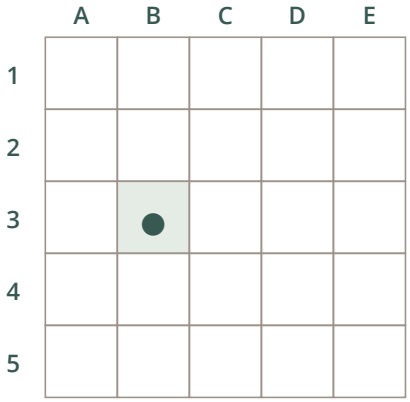

← ↑ → ↑ ↓

= _____

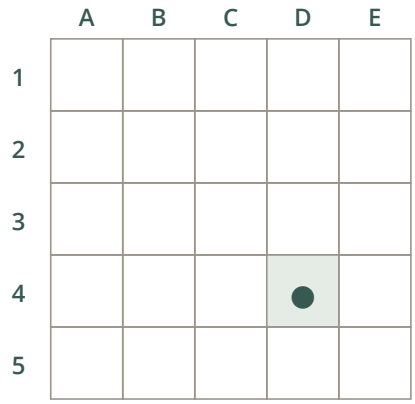

↓ ← → ← → →

= _____

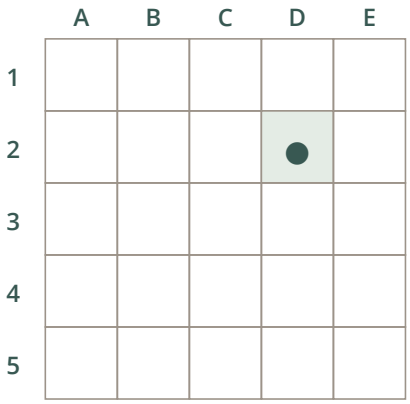

→ ↑ ↓ ↓ ← ← ↑

= _____

Drumuri cu săgeți prin zăpadă

Pornește din căsuța marcată. Fiecare săgeată înseamnă un pas. Scrie coordonatele căsuței în care ajungi.

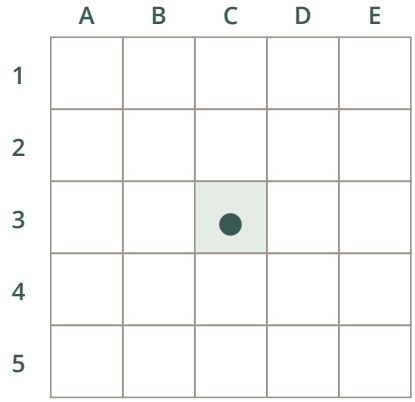

↓ ← ↓ ↑

= B4

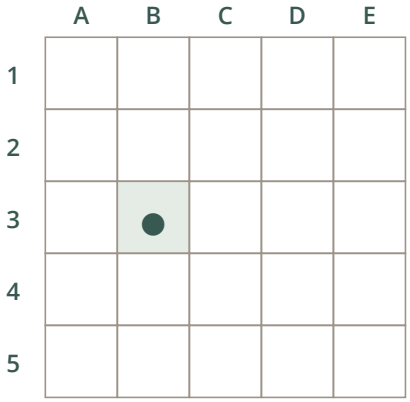

← ↑ → ↑ ↓

= B2

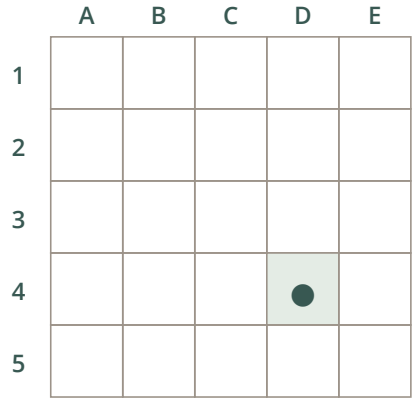

↓ ← → ← → →

= E5

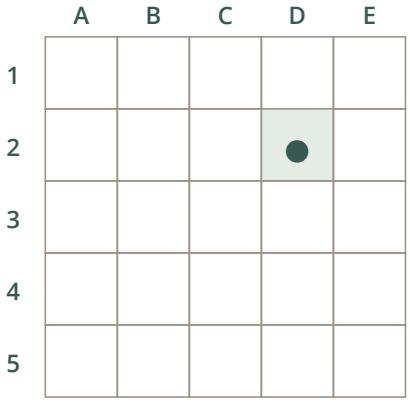

→ ↑ ↓ ↓ ← ← ↑

= C2